Telling time to the minute; analog ↔ digital

MODULE 6 · TIME AND MONEY MEASURES

HOW TO ANSWER TODAY

- **12-hour ↔ 24-hour.** 24-hour uses 00–23, no am/pm. For pm times, add 12 to the hour.
  3:30 pm → 15:30 08:15 → 8:15 am
- **Read an analog clock.** Hour hand (short) → which hour. Minute hand (long) → minutes, counting in 5s.
  Hour hand past 10, minute hand on 3 → 10:15

STRETCH PROBLEMS

1. The Late Late Toy Show finishes at **23:15** on the RTÉ guide that Oisín reads at home. Write this time in **12**-hour format instead.

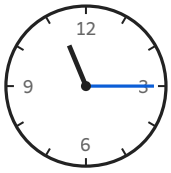

2. The Camogie training timetable at Aoife's club lists the drills starting at **11:15** in **24**-hour time. Write this start time in **12**-hour time.

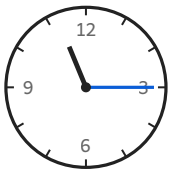

3. The Aer Lingus flight from Dublin to Spain for the school exchange leaves at **11:25** am. Write this departure time in **24**-hour time.

4. The whole-school assembly finishes at **1:35** pm, just after the lunch break in 4th class. Write this finishing time in **24**-hour time.

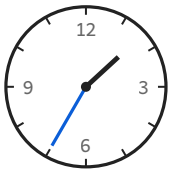

5. Before the school tour bus leaves for Glendalough, Cian checks the classroom clock. The minute hand points to the **9** and the hour hand sits between the **1** and the **2**, in the afternoon. Write this time in **24**-hour form.